Exempel intagningsprov teori

Oskarshamn Folkhögskola

Skriv följande intervaller



Skriv ackorden



E Am D7 Gmaj C6 F#m7 Bm7-5 Edim

Skriv en A-moll harmonisk skala



Vilka är ackorden, skriv ackordens namn



G-Dur I IV IIm7 V7 I



G-Dur T S Sp7 D7 T

Sätt ut ackord till denna melodi



©osk